8.1.21

Maths Meeting

L.I: I can answer division questions by using objects, pictures and other equipment. (band 1)









8.1.21

Maths Meeting

L.I: I can answer questions involving division mentally and with objects.(band 2)

Circle groups of 2.

	How many tomatoes? _____ How many groups? _____
	How many mangoes? _____ How many groups? _____
	How many kiwi fruit halves? _____ How many groups? _____
	How many pineapples? _____ How many groups? _____
	How many strawberries? _____ How many groups? _____