MONDAY

1. What is the time?
2. (3 x 7) x 4 = 3 x (x 4)
3. Share £90.00 among 9 people.

   £ each
4. Share £90.00 among 18 people.

   £ each
5. 70 + 60 =
6. 300 – 70 =
7. 4005 m = km m
8. 0.9 x 2 =
9. Draw a reflection of: gh
10. 7 + 7 + 7 + 7 =
11. Is a sharpener symmetrical?
12. 3909 < 4990 ☐ *true* ☐ *false*
13. 3 hours 30 min. add 2 hours 45 min. =

    hour(s) minute(s)
14. $^{7}/_{10}$ = 0.
15. Share 30 apples between 6 people. How many each? Complete the number sentence.

    =

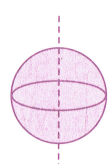

16. Double 17.
17. What 2-D shape will be made after the cut?
18. What is the date a week before New Year's Day?
19. 6 + 7 + 4 =
20. 4 3
    x 2

TUESDAY

1. What is the time?
2. How long is $^{4}/_{5}$ of 1 metre? cm
3. 8 + 9 =
4. 0.8 + 10 =
5. 60 + 90 =
6. 0.9 + 0.1 =
7. Is the line of symmetry: ☐ *vertical?* ☐ *horizontal?* ☐ *diagonal?*

8. This is a .

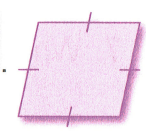

9. 5 x 8 =
10. Julie weighs 34.2 kg. Todd weighs 35.7 kg. How much do they weigh altogether?

    kg
11. 500 – 70 =
12. 4050 mL = litres mL
13. =
14. What is the difference between 14 and 8?
15. 4 1
    x 2
16. Double 36.
17. 9 + 7 + 4 =
18. Tick which is more likely to happen.
    ☐ *You will fly to London tonight.*
    ☐ *You will go to bed tonight.*
19. 60 x 5 =
20. $^{4}/_{5}$ = $/_{10}$

WEDNESDAY

1. What is the time?
2. £11.25 + £14.75 =
3. £20.00 – £3.80 =
4. 30 + 90 =
5. What device would you use to measure the length of a room?
6. 40 ÷ 5 =
7. 2 hours 45 min. add 4 hours 45 min. =

   hour(s) minute(s)
8. What type of triangle?

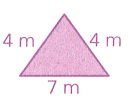

9. 7090 m = km m
10. What 2-D shape will be made after the cut?

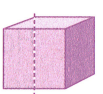

11. 14 – 9 =
12. Tick which is less likely to happen tomorrow.
    - ☐ *The sky will have some clouds.*
    - ☐ *The sky will turn green.*
13. Is 4 or 8 a factor of 20?
14. 320 – 40 =
15. The sum of 5 and 7 =
16. Share 45p between 9 people. How much each? Complete the number sentence.

    =
17. 0.3 x 7 =
18. Cost of laying 100 m of cable at £2.50 per metre?
19. Halve 70.
20. 40 x 5 =

THURSDAY

1. What is the time?
2. 302 – 9 =
3. (5 x 2) x 10 = 5 x (x 10)
4. Perimeter of a rectangle 25 cm by 40 cm?

   cm
5. =
6. 2 3
   x 3
7. 40 + 70 =
8. $^1/_4$ of 500 =
9. There is 2.2 kg of flour, 3.1 kg of sugar and 1.6 kg of cocoa powder. What is the total weight?

   kg
10. This is an irregular .

11. Halve 72.
12. 0.1 x 5 =
13. How long is $^1/_4$ m of ribbon? cm
14. What is the chance of you becoming an astronaut?
15. 430 – 80 =
16. 7999 mL = litres mL
17. £20.00 – £0.80 =
18. 6 x 9 =
19. Is the line of symmetry:
    - ☐ *vertical?*
    - ☐ *horizontal?*
    - ☐ *diagonal?*

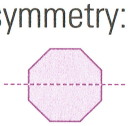

20. Write the numeral seven thousand and fifty-seven.